My Castle

Object	How Many Objects?
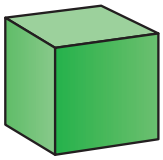	
	
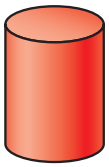	
	

My castle has _____ objects.
(how many)

My castle has _____ vertices.
(how many)